GRADE 9+

Extended Programme

SOCIAL & MODERN STUDIES

Practice Paper 1
45 Minutes

Read these instructions first

- Write your name in the space provided below.
- Use black or blue ink.
- HB pencils may be used for the diagrams / sketches only.
- Do not use correction fluid.
- Read each question carefully.
- All answers must be written in the spaces provided.
- Answer all questions.
- The number of marks is given in the brackets [ ] at the end of each question or part question.
- The total mark for this paper is 50 marks.

Name of student : .....

QUESTION 1

Circle the letter which shows the correct answer.

1. In which year did Mauritius become an independent country?

A 1810
B 1968
C 1992
D 2020

2. Which island was granted autonomy in 2002?

A Mauritius
B Agalega
C St Brandon
D Rodrigues

3. Who became the first President of Mauritius?

A Sir John Shaw Rennie
B Sir Abdool Raman Osman
C Sir Seewoosagur Ramgoolam
D Sir Veerasamy Ringadoo

4. The main objective of the Export Processing Zone was to ..... .

A increase poverty
B increase the number of tourists
C encourage imports
D encourage exports

5. In 1973, Mauritius obtained a certificate of malaria elimination from ..... .

A WHO
B UN
C SADC
D COMESA

6. In 1975, cyclone …… destroyed many houses in Mauritius.

A Hollanda
B Dina
C Gervaise
D Alix

7. Better standards of living in Mauritius have increased …… .

A poverty
B death
C life expectancy
D famine

8. Vitamins and milk were given to …… because there were too many cases of malnutrition.

A old people
B children
C men
D women

9. In the 1960s, the number of …… cases were very high in Mauritius.

A malaria
B diabetes
C chikungunya
D covid 19

10. Demography is the study of the …… .

A population
B economy
C environment
D stars

(10 marks)

QUESTION 2

For each picture, fill in the blanks with the correct word. Choose from the words provided in brackets.

Picture 1

People leave their countries because of push factors such as ..... **(war, employment)**

Picture 2

The family is an important agency of ..... . **(socialisation, organisation)**

Picture 3

In the pre-industrial society, men worked mostly in ..... . **(industries, fields)**

(3 marks)

QUESTION 3

Match each acronym with its corresponding organisation.

1.	**IORA**	Southern African Development Community
2.	**COMESA**	Indian Ocean Rim Association
3.	**SADC**	United Nations
4.	**UN**	Organisation International de la Francophonie
5.	**OIF**	Common Market for Eastern and Southern Africa

(5 marks)

QUESTION 4

Read each statement and tick (√) in the appropriate box

		TRUE	**FALSE**
a	In Mauritius, better health facilities in 1960s led to the decline in birth rate.		
b	Most people were poor in Mauritius at the time of independence.		
c	Mauritius is not a member of SADC.		
d	Unity and stability are needed for a society to function properly.		
e	Industrialisation has improved the standard of living of people in Mauritius.		

(5 marks)

QUESTION 5

Map 1 shows the islands of the Republic of Mauritius. Study the map and answer the questions.

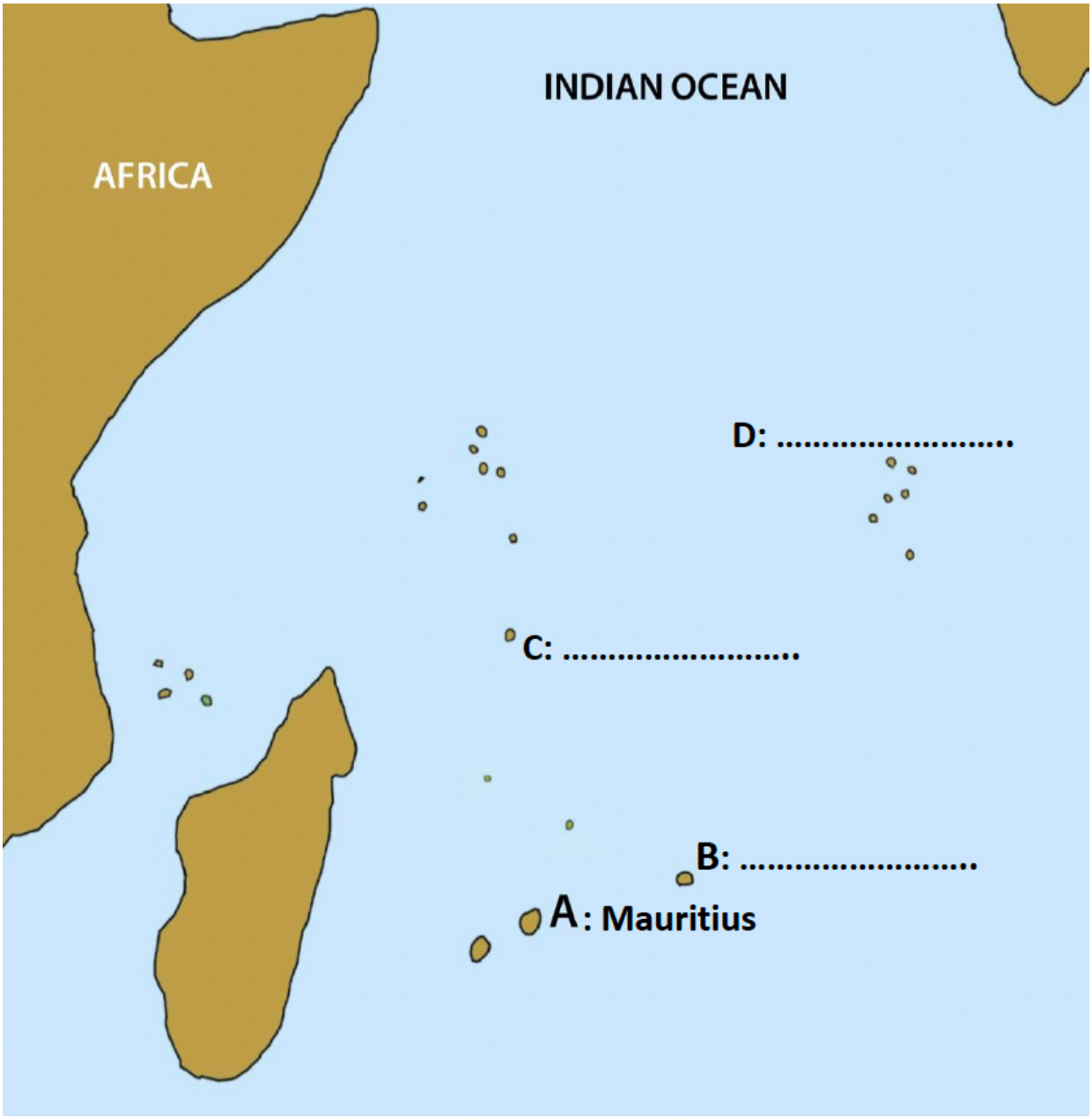

(a) On Map 1, name islands **B** to **D** that form part of the Republic of Mauritius.
Island A, Mauritius has been done for you.

(3 marks)

(b) Name two products which were exported from the Chagos Archipelago to Mauritius in the 18th century.

(i) .....

(ii) .....

(c) Name one vegetable cultivated by the Chagossians in the 18th century.

.....

(d) On which island of Chagos Archipelago is a military base built?

.....

(e) Name the country that has the military base on the island you mentioned above.

.....

(8 marks)

QUESTION 6

For each sentence, fill in the blanks with the correct word.

1. In Rodrigues, the inhabitants are engaged in agriculture and .....

(mining, fishing)

2. A ..... is the count of all the people and households in a country.

(census, election)

3. People who leave their home country to settle permanently in Mauritius are called

..... . **(immigrants, emigrants)**

4. Population ..... refers to the composition of a population.

(census, structure)

5. The United States of America has a military base on .....

(Agaléga, Diego Garcia)

(5 marks)

QUESTION 7

Fill in the blanks. Choose from the list of words provided below.

French Indian sugar industry welfare industrialisation

1. The process of setting up of industries is known as ..... .

2. In a ..... state, the government is responsible for the well-being of the citizens.

3. The Mahatma Gandhi Institute preserves the cultural heritage of the ..... immigrants.

4. Mauritius depended mainly on the ..... in the 1960s.

5. In 1721, the ..... started a settlement at Grand Port.

(5 marks)

QUESTION 8

Study the table below which shows the population statistics of the Republic of Mauritius.

ISLAND	MALE	FEMALE	TOTAL
MAURITIUS	604,899	617,318	1,222,217
RODRIGUES	21,016	21,802	42,818
AGALEGA	174	100	274
ST-BRANDON	-	-	-
REPUBLIC OF MAURITIUS	626,089	639,220	1,265,309

1. Which island is the **most** populated? .....

2. Which island is the **least** populated? .....

3. What is the population of **Mauritius**? .....

4. What is the **number of male** population in **Agalega**? .....

5. On which island is the **number of males higher than the number of females**? .....

6. What is the **total** population of **Republic of Mauritius**? .....

(6 marks)

GRADE 9+

Extended Programme

SOCIAL & MODERN STUDIES

Practice Paper 2
45 Minutes

Read these instructions first

- Write your name in the space provided below.
- Use black or blue ink.
- HB pencils may be used for the diagrams / sketches only.
- Do not use correction fluid.
- Read each question carefully.
- All answers must be written in the spaces provided.
- Answer all questions.
- The number of marks is given in the brackets [ ] at the end of each question or part question.
- The total mark for this paper is 50 marks.

Name of student : .....

QUESTION 1

Circle the letter which shows the correct answer.

1. Population ..... is the spread of population over an area.

A density
B distribution
C area
D densely

2. In January 1960, cyclone ..... affected Mauritius.

A Carol
B Dina
C Gervaise
D Hollanda

3. The Jin Fei Smart City is being developed in Mauritius through a partnership with ..... .

A Madagascar
B Australia
C Singapore
D China

4. In the 1960s, milk and vitamins were provided to the children because they were suffering from ..... .

A polio
B malaria
C malnutrition
D tuberculosis

5. The ..... won the General Elections in August 1967.

A Parti Mauricien
B Mauritius Labour Party
C Independent Forward Bloc
D Independence Party

6. UN stands for ..... .

A United Nations
B Union of Nations
C Unity for Nations
D United News

7. The internet is an example of ..... media

A digital
B audio
C print
D traditional

8. In the 1960s, the Central Housing Authority (CHA) was set up by the ..... government in Mauritius.

A Malagasy
B Colonial
C Local
D Indian

(8 marks)

QUESTION 2

Map 1 shows the islands of Agalega. Study it carefully. Then answer the questions.

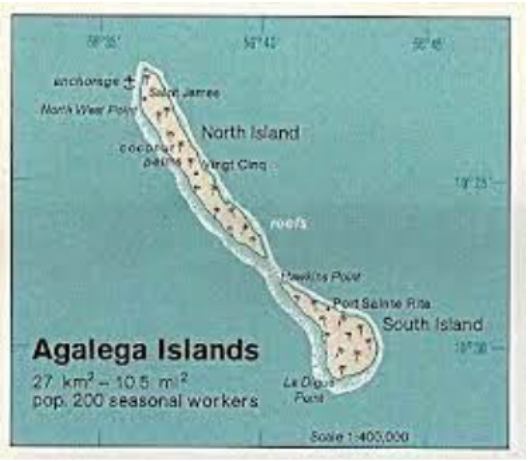

1. Name the two islands of Agalega.

(i) .....

(ii) .....

2. Name any one village in Agalega.

.....

(3 marks)

QUESTION 3

Match each picture with the correct family type.

Nuclear family

Extended family

Single-parent family



(3 marks)

QUESTION 4

Use the words below to complete the table. One has been done for you.

Britain China Mozambique Slaves Free workers ~~Colonists~~

Continent	Country of Origin	Who were they?
Europe		Colonists
Africa		
Asia		

(5 marks)

QUESTION 5

Read each statement and tick (√) in the appropriate box

		TRUE	FALSE
a	The media influence what people eat.		
b	Voluntary migration is when people choose to leave their home country to settle elsewhere.		
c	An increase in birth rate is a cause of population change.		
d	Senior citizens pay bus fares in Mauritius.		
e	Tromelin forms an integral part of the United Kingdom.		

(5 marks)

QUESTION 6

Match each picture to show the way of life of people in pre-industrial society.

Sugar cane was the main crop which was cultivated.

Houses were made up of wood and thatched roof.

Most people lived in large extended families.

(3 marks)

QUESTION 7

Fill in the blanks in the sentences. Choose from the list of words provided below.

children nuclear Rodrigues industrialisation Chagossians norms

1. Rodrigues has not experienced the ..... process.

2. Between 1971 and 1972, some ..... were moved to Mauritius.

3. In the past, many ..... worked at an early age.

4. The ..... family consists of the parents and the children living together.

5. Deviance refers to any action that is against the .....of a society.

(5 marks)

QUESTION 8

Complete Figure 1 with four other examples of mass media.

Figure 1

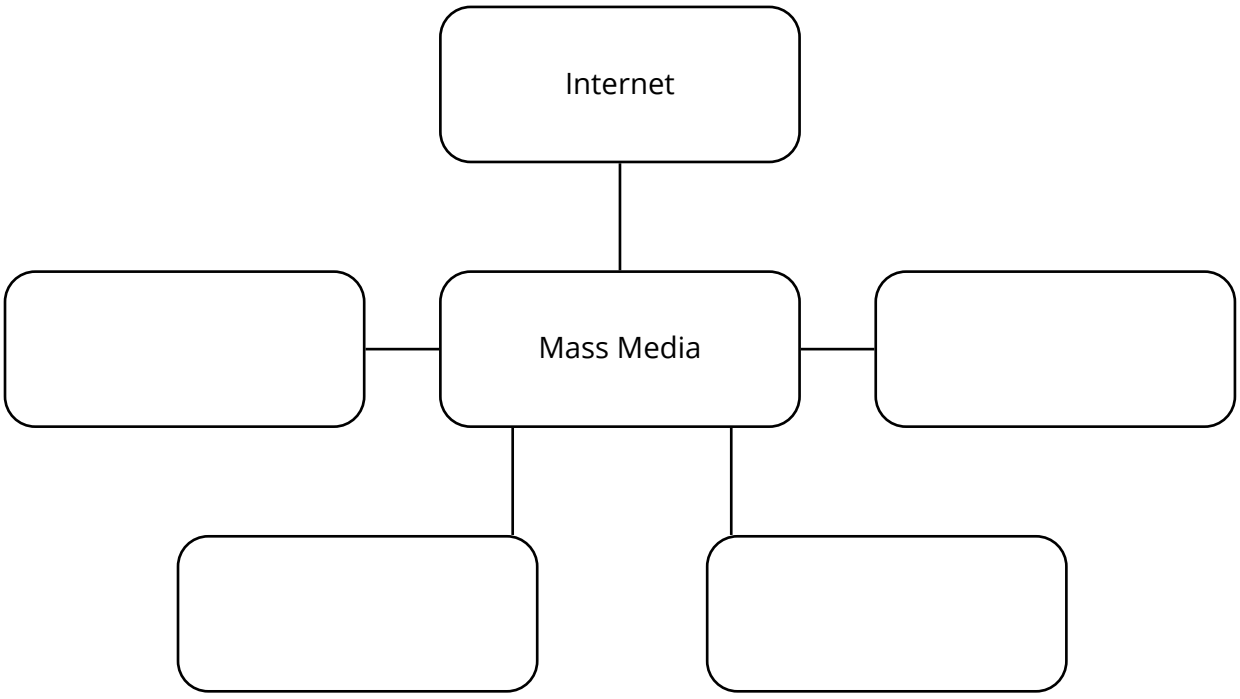

(4 marks)

QUESTION 9

Fill in the blanks with correct word/s.

1. Newspapers and ..... are examples of print media. **(television, magazines)**

2. People are attracted to live in places where there are ..... . **(fertile soil, marshy lands)**

3. An area where very few people live is ..... populated**. (sparsely, densely)**

4. Nowadays, children ..... the age of 16 are not allowed to work. **(above, below)**

5. In 1980s, the textile industry expanded rapidly in ..... . **(St Brandon, Mauritius)**

(5 marks)

QUESTION 10

Complete the sentences below.

1. Socialisation is the process of ..... .

2. Through primary socialisation, children learn ..... .

3. Through secondary socialisation, children learn ..... .

(3 marks)

QUESTION 11

1. Complete the sentence below.

Migration is the movement of ..... .

(2 marks)

2. Give **two examples** of internal migration in Mauritius.

(i) .....

(ii) .....

(2 marks)

3. Name **two countries** to which Mauritians have **emigrated.**

(i) .....

(ii) .....

(2 marks)

GRADE 9+

Extended Programme

SOCIAL & MODERN STUDIES

Practice Paper 3
45 Minutes

Read these instructions first

- Write your name in the space provided below.
- Use black or blue ink.
- HB pencils may be used for the diagrams / sketches only.
- Do not use correction fluid.
- Read each question carefully.
- All answers must be written in the spaces provided.
- Answer all questions.
- The number of marks is given in the brackets [ ] at the end of each question or part question.
- The total mark for this paper is 50 marks.

Name of student : .....

QUESTION 1

Circle the letter which shows the correct answer.

1. In a republic, the ..... is the Head of State.

A President
B Prime Minister
C King
D Speaker

2. Before industrialisation, Mauritius depended mainly on the ..... .

A manufacturing sector
B tourism sector
C financial sector
D agricultural sector

3. The Institut Français de Maurice (IFM) provides training to those interested in studies in ..... .

A India
B Australia
C France
D China

4. The count of all people and households in a country is a ..... .

A census
B policy
C demography
D structure

5. The government of Mauritius receives money from ..... to provide welfare benefits.

A taxes
B pensions
C personal loans
D sponsors

6. A ..... family consists of only one parent and dependent children living under the same roof.

A single parent
B nuclear
C reconstituted
D extended

7. In Mauritius, formal education is compulsory for children till the age of

A 12
B 15
C 16
D 18

8. Which one of the following is the smallest amongst the Mascarene Islands?

A Réunion
B Mauritius
C Rodrigues
D Agaléga

(8 marks)

QUESTION 2

Match words in **Column A** with the correct statement in **Column B**. Fill in the grid below with the letter which matches with the terms.

Column A	**Column B**
1. Chagos Archipelago	A. is the setting up of industries.
2.Constitution	B. was called Ile de Sable.
3.Industrialisation	C. is the taking over of activities of smaller sugar mills by big sugar mills.
4. Centralisation	D. is the supreme law of a country.
5. Tromelin	E. separated Chagos Archipelago from Mauritius in 1965.
6. Britain	F. was also known as Oil Islands.

1	2	3	4	5	6

(6 marks)

QUESTION 3

(b) State whether the following statements are True or False

(i) Mauritius was a Dutch colony**.** **.....**

(ii) The Independence Party won the elections in 1967**.** **.....**

(iii) There is only one health centre in Rodrigues**.** **.....**

(iv) In 1968, American troops were called to maintain order in Mauritius**.** **.....**

(v) Sir Seewoosagur Ramgoolam wanted integration with Britain in 1968. **.....**

(5 marks)

QUESTION 4

Each picture below shows examples of changing roles of men and women.
Match each picture in column A with the correct statement in column B.

Column A	Column B
	Men and women have equal rights.
	Men and women share household tasks.
	Men and women have equal opportunities.
	Both girls and boys have access to education.

(8 marks)

QUESTION 5

Fill in the blanks in the sentences. Choose from the list of words provided below.

French lifestyle vote democracy
poverty territory zone franche ~~African~~

1. The Nelson Mandela Centre for African culture has been created to make people aware of **African** culture.

2. The ..... took possession of Mauritius after the departure of the Dutch.

3. With the creation of the ..... in the 1970s, women became breadwinners.

4. A Welfare State seeks to remove ..... and hunger.

5. In Mauritius, both men and women have the right to ..... .

6. Media play an important role in maintaining a healthy ..... .

(5 marks)

QUESTION 6

Complete the sentences below.

(a) An economy that depends on a single crop is known as a ..... economy.

(b) The main crop grown in Mauritius in 1960s was ..... .

(c) Two economic activities in Rodrigues are ..... and ..... .

(d) In Mauritius, the textile sector in the 1980s provided ..... .

(8 marks)

QUESTION 7

Complete the table. Choose from the list of words provided.

An example has been provided.

War employment ~~poverty~~ famine ~~education~~ safe environment

Push factors	Pull factors
Poverty	*Education*

(4 marks)

QUESTION 8

For each picture, write one sentence to describe the criminal act shown.

Picture 11

.....

.....

Picture 12

.....

.....

Picture 13

.....

.....

(6 marks)

GRADE 9+

Extended Programme

SOCIAL & MODERN STUDIES

Practice Paper 4
45 Minutes

Read these instructions first

- Write your name in the space provided below.
- Use black or blue ink.
- HB pencils may be used for the diagrams / sketches only.
- Do not use correction fluid.
- Read each question carefully.
- All answers must be written in the spaces provided.
- Answer all questions.
- The number of marks is given in the brackets [ ] at the end of each question or part question.
- The total mark for this paper is 50 marks.

Name of student : .....

QUESTION 1

Circle the letter which shows the correct answer.

1. Who became the first president of Mauritius in 1992?

A Sir Seewoosagur Ramgoolam
B Sir Veerasamy Ringadoo
C Sir Gaëtan Duval
D Sir John Shaw Rennie

2. Which island of the Republic of Mauritius was granted autonomy in 2002?

A Rodrigues
B St Brandon
C Agaléga
D Chagos Archipelago

3. In the 1960s, Mauritius was considered a monocrop economy because it depended mostly on the …… .

A textile industry
B tourism industry
C sugar industry
D information and communication technology

4. Mauritius provides social benefits such as free health care and free education to its citizens. Mauritius is …… .

A a sovereign state
B a welfare state
C a democratic state
D an independent state

5. The government obtains money to fund welfare benefits from …… .

A taxes
B bank interest
C salary
D loans

6. A family type with one parent and dependent children is known as ..... .

A a nuclear family
B an extended family
C a single-parent family
D a reconstituted family

7. In the 1960s, which of the following goods were imported by Mauritius?

A Oil
B Tea
C Laptops
D Sugar

8. The Export Processing Zone (EPZ) was set up to increase ..... .

A jobs
B imports
C births
D exports

(8 marks)

PART B

For each picture, fill in the blanks with the correct word. Choose from the list of words given.

In the 1940s, most people were living in houses made of wood and ..... . **(concrete, straw)**

In the 1940s, ... were used to carry sugar cane. **(cars, ox carts)**

Cyclone Gervaise caused much damage to ..... **(buildings, forests)**

(3 marks)

QUESTION 2

The Republic of Mauritius comprises of various islands.

(a) Name **two** islands that form part of the Republic of Mauritius.

(i) .....

(ii) .....

(2 marks)

(b) Tick (✓) **True** or **False** next to each of the statements below.

		TRUE	FALSE
(i)	Agaléga is composed of two atolls		
(ii)	There is a university in Agaléga		
(iii)	Fishing is the main activity in Agaléga		
(iv)	Many tourists visit Tromelin each year		
(v)	Seychelles is part of the Republic of Mauritius		

(5 marks)

QUESTION 3

1. Fill in the blanks. Choose from the list of words given below.

health vote President crime monocrop

(i) Before independence, Mauritius was a ..... economy.

(ii) In the 1960s, the life expectancy increased because of improved ..... care.

(iii) The ..... of Mauritius is the head of state.

(iv) Citizens of Mauritius can ..... at the age of 18 and above.

(v) Any kind of behaviour against the law is a ..... .

(5 marks)

2. Table 2 below shows the number of passenger arrivals at the airport of Plaine Corail in 1997 and in 2017.

Study Table 2 and fill in the blanks.

Table 2

Year	Number of arrivals
1997	37,765
2017	97,827

(a) The number of tourist arrivals in 1997 was ..... . (**1 mark)**

(b) (i) From 1997 to 2017, the number of passenger arrivals by plane ..... .

(**increased, decreased)** (**1 mark)**

(ii) Give **one** reason why.

.....

(**1 mark)**

QUESTION 4

(a) Tick (✓) **True** or **False** next to each of the statements below.

		TRUE	**FALSE**
(i)	The Constitution is the supreme law of Mauritius		
(ii)	The Central Housing Authority (CHA) collects taxes		
(iii)	There is one major hospital in Rodrigues at Crève Coeur		
(iv)	Industrialisation led to better living standards		
(v)	In the 1960s, unemployment was a major social problem		

(5 marks)

QUESTION 5

1. Match each picture in **Column A** to the correct family type in **Column B**. Use the grid provided below**. The first one has been done for you.**

	Column A		Column B
1.		**A.**	**Single Parent Family**
2.		**B.**	**Reconstituted Family**
3.		**C.**	**Extended Family**
4.		**D.**	**Nuclear Family**

Answer Grid

Column A	**1**	**2**	**3**	**4**
Column B	**B**			

(3 marks)

2. Print media, new digital media and electronic media are different types of media.

Complete **Table 3** with the examples of media provided in the box below.

Newspaper	Internet	Twitter	Television
Radio	Facebook	Billboard	

Print media	New digital media	Electronic media

Table 3

(7 marks)

QUESTION 6

The box below shows some historical events in Mauritius. Write each correct event for its corresponding year in Table 4 below.

Mauritius becomes a republic	Free secondary education introduced
Mauritians are eligible to vote	Mauritius obtains independence

Table 4

YEAR	EVENT
1968	
1976	
1977	
1992	

(4 marks)

QUESTION 7

Figure 1 shows five countries to which Mauritians have emigrated in the year 2000.

Figure 1

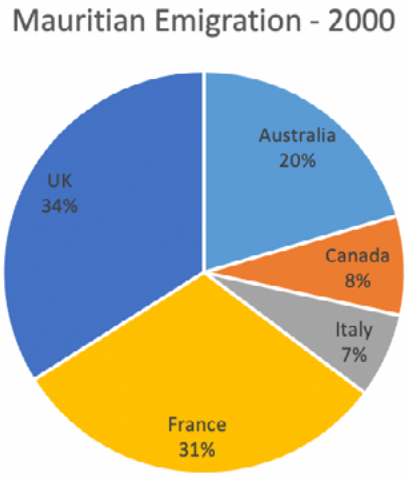

(a) Study Figure 1 and answer the question below.

(i) The percentage of Mauritian emigrants who settled in Italy is ..... . **(34%, 7%)**.

(ii) Most Mauritians emigrated to ..... **(UK, France)**.

(iii) The percentage of Mauritians that emigrated to the UK is ..... **(20%, 34%)**

(**3 marks)**

(b) Suggest **one** reason why Mauritians emigrated to these countries.

.....

(2 marks)

GRADE 9+

Extended Programme

SOCIAL & MODERN STUDIES

Practice Paper 5
45 Minutes

Read these instructions first

- Write your name in the space provided below.
- Use black or blue ink.
- HB pencils may be used for the diagrams / sketches only.
- Do not use correction fluid.
- Read each question carefully.
- All answers must be written in the spaces provided.
- Answer all questions.
- The number of marks is given in the brackets [ ] at the end of each question or part question.
- The total mark for this paper is 50 marks.

Name of student : .....

QUESTION 1

PART A

Circle the letter which shows the correct answer.

1. Mauritius became a republic in ..... .

A 1968
B 1992
C 1999
D 2005

2. The supreme law of Mauritius is the ..... .

A constitution
B government
C democracy
D sovereignty

3. After cyclones 'Alix' and 'Carol', the ..... was set up to tackle the housing problem in Mauritius.

A Mauritius Revenue Authority
B World Trade Organisation
C Central Housing Authority
D World Health Organisation

4. In Mauritius, the population increased after the 1940s because of lower ..... rate.

A marriage
B birth
C death
D divorce

5. In the 1960s, the ..... industry was the main source of revenue for Mauritius.

A textile
B services
C sugar
D fishing

6. In Rodrigues, people depended mainly on …… in the 1960s.

A mining
B fishing
C banking
D manufacturing

7. In Mauritius, the Import Substitution Industry Strategy (ISI) was adopted to reduce …… .

A exports
B costs of production
C imports
D profits

8. In the production process in a factory, raw materials are an example of …… .

A input
B transformation
C manufacturing
D output

(8 marks)

PART B

Map 2 shows some countries with which Mauritius has historical links. Study the map and answer the questions that follow.

Map 2

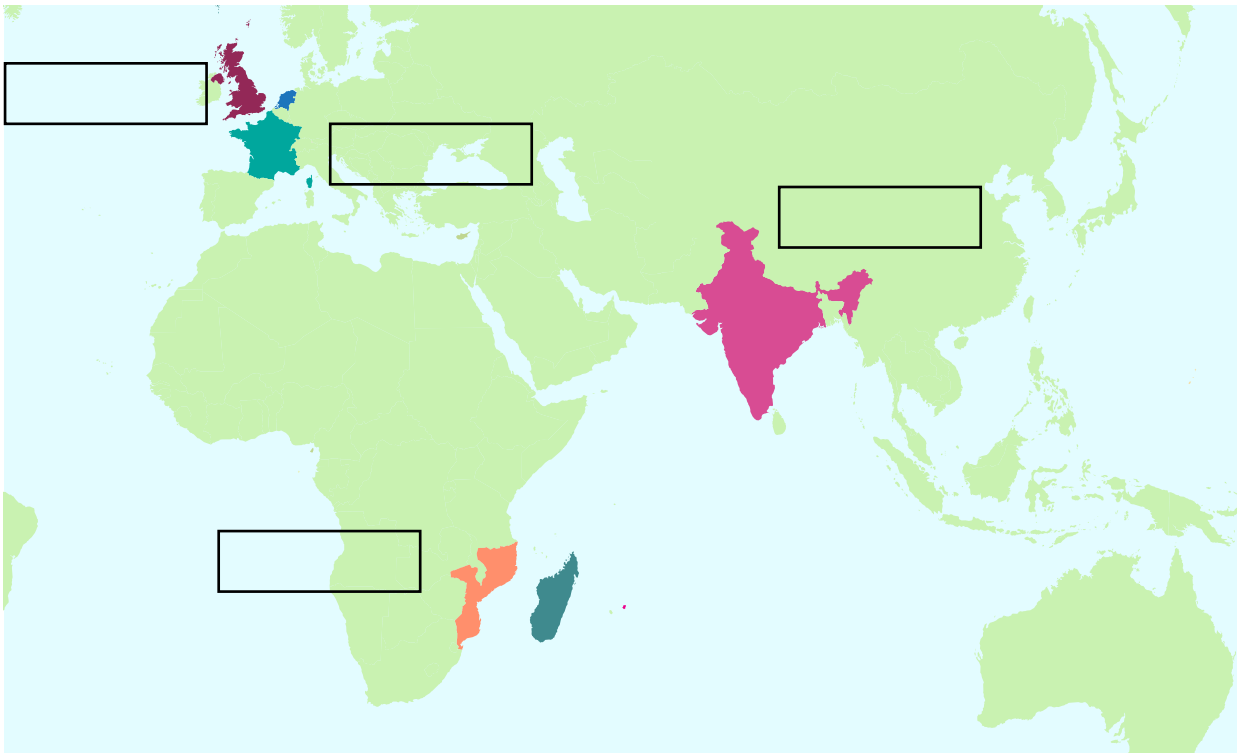

(a) Label the countries in the boxes provided. Choose from the list of countries provided below:

India **France** **Britain** **Mozambique** **(4 marks)**

(b) On the map, label the island of **Madagascar** with the letter **'A'.** **(1 mark)**

(c) Name **two** islands that form part of the Republic of Mauritius.

(i) .....

(ii) ..... **(2 marks)**

QUESTION 2

(a) State whether the following statements are **TRUE** or **FALSE.**

(i) The Alliance Française helps to maintain ties with France. .....

(ii) India has contributed to the building of the Cybercity in Mauritius. .....

(iii) The ties between Africa and Mauritius dates to 19th century. .....

(iv) Mauritius is a member of the United Nations. .....

(v) The French named our island Ile Maurice. .....

(5 marks)

(b) Label pictures A and B. Choose from the list provided below

Mahatma Gandhi Institute **Indira Gandhi cultural centre** **Alliance Française**

A: ..... B:.....

(2 marks)

QUESTION 3

1. Fill in the blanks. Choose from the words below.

export	**unemployment**	**wages**	**textile**	**industry**

(i) The sugar industry was often affected by an increase in ..... of workers.

(ii) Mauritius obtained most of its revenue from ..... of sugar.

(iii) In the 1960s, Mauritians were mostly employed in the sugar .....

(iv) The Export Processing Zone (EPZ) was set up to solve the problem of .....

(v) In the 1980s, the ..... industry expanded rapidly.

(5 marks)

2. Match the Pictures in **Column A** with the words in **Column B**

Column A	Column B
	Tourism sector
	Banking & Financial services
	Sugar industry
	Textile industry

(4 marks)

QUESTION 4

(a) Study Pictures A and B and answer the questions below.

Picture A - Electronic media

Picture B - New Age Digital Media

(i) Give **two** examples of electronic media

1. .....

2. ..... **(2 marks)**

(ii) Give **two** examples of new age digital media

1. .....

2. ..... **(2 marks)**

(b) Write **one** use of social media.

.....

.....

(1 mark)

QUESTION 5

1. Table 1 shows the number of women working in Mauritius between 1975 and 1989.

Table 1

Year	1975	1980	1985	1989
Number of women working	38615	52180	70079	96900

Study Table 1 and fill in the blanks.

(a) The number of women working in 1975 was .....

(b) The number of women working in 1985 was .....

(c) In which year was the number of working women 52180? .....

(d) In which year was the number of working women highest? .....

(4 marks)

2. Fill in the blanks in sentences (a) to (d). Choose the correct word given in brackets.

(a) The composition of a population is usually shown in population .....
(pyramid, density)

(b) People aged 65 and above are called ..... population.
(young, elderly)

(c) People who are forced to leave their country are called .....
(tourists, refugees)

(d) Before 1940, birth rates and death rates were ..... in Mauritius.
(high, low)

(e) In the 1980s, the ..... industry expanded rapidly.
(sugar, textile)

(5 marks)

QUESTION 6

Read the questions below carefully and answer them.

(a) Name **one** job in the sugar industry.

..... **(1 mark)**

(b) State **two** benefits provided by the welfare state.

(i) .....

(ii) ..... **(2 marks)**

(c) Name **two** family types.

(i) .....

(ii) ..... **(2 marks)**

GRADE 9+

Extended Programme

SOCIAL & MODERN STUDIES

Practice Paper 6
45 Minutes

Read these instructions first

- Write your name in the space provided below.
- Use black or blue ink.
- HB pencils may be used for the diagrams / sketches only.
- Do not use correction fluid.
- Read each question carefully.
- All answers must be written in the spaces provided.
- Answer all questions.
- The number of marks is given in the brackets [ ] at the end of each question or part question.
- The total mark for this paper is 50 marks.

Name of student : .....

QUESTION 1

PART A

Circle the letter which shows the correct answer

1. Which of the following health problems were common among children in the 1960s?

A Tuberculosis
B Covid-19
C Obesity
D Malnutrition

2. In the 1960s, Mauritius depended mainly on the ..... industry.

A Sugar
B Tourism
C Manufacturing
D BPO

3. In Mauritius, taxes are collected by the ..... .

A Central Housing Authority
B World Trade Organisation
C Mauritius Revenue Authority
D World Health Organization

4. In 1970, the Export Processing Zone (EPZ) was set up to increase ..... .

A imports
B taxes
C exports
D services

5. Which of the following is an example of social media?

A Newspaper
B Facebook
C Television
D Magazines

6. Rodrigues was granted autonomy in …… .

A 1968
B 1976
C 1992
D 2002

7. The main economic activity in Agaléga is the production of …… .

A textiles
B sugar
C coconut oil
D rice

8. A family type with grand-parents, parents, children and other relatives living together is …… .

A a nuclear family
B an extended family
C a single-parent family
D a reconstituted family

(8 marks)

PART B

For each picture, fill in the blanks with the correct word. Choose from the words given in brackets.

In the past, many women worked in ..... **(fields, offices)**

In modern Mauritius, many educated women earn ..... salaries, compared to the past.

(higher, lower)

Nowadays, tertiary education in Mauritius is .....

(compulsory, free)

(3 marks)

QUESTION 2

Figure 1 shows the tracks of cyclone 'Alix' and 'Carol'. Study the figure and answer the questions.

Figure 1

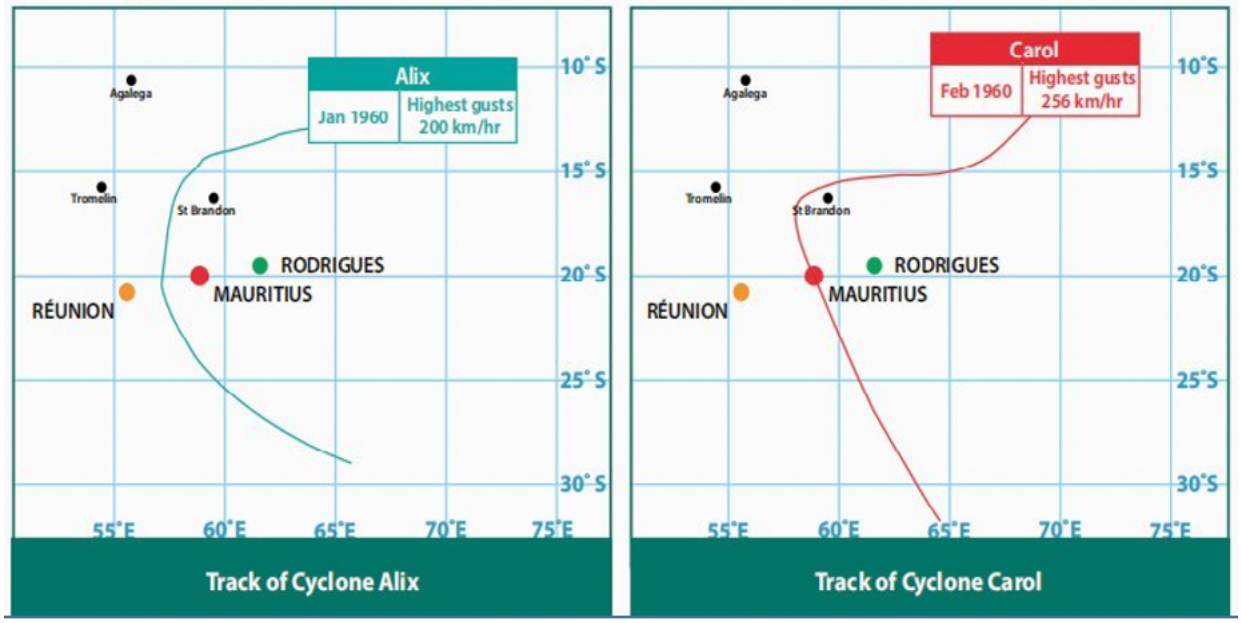

(a) Name the two cyclones shown in Figure 1.

(i) .....

(ii) ..... **(2 marks)**

(b) Cyclone 'Alix' affected Mauritius during the month of ..... .

(January, February) **(1 mark)**

(c) Cyclone 'Carol' caused ..... damage to Mauritius. **(much, little)**

(1 mark)

(d) Write one sentence to describe how cyclones affect:

(i) The environment : .....

(ii) Human lives : .....

(2 marks)

QUESTION 3

1. Fill in the blanks. Choose from the list of words given below.

export	television	jobs	reproduction	Africa

(i) Slaves were forcibly brought to Mauritius from .....

(ii) One of the main functions of the family is .....

(iii) The textile industry created many ..... for women.

(iv) Goods produced in the EPZ were mainly for .....

(v) An example of electronic media is .....

(5 marks)

2. Match the years in **Column A** to the events in **Column B .**

Use the grid below to write your answer.

Column A	**Column B**
(a) 1968	1. Free secondary education was introduced
(b) 1976	2. Mauritius became an independent country
(c) 1977	3. Rodrigues was granted autonomy
(d) 1992	4. Mauritians aged 18 were eligible to vote
(e) 2002	5. Mauritius became a republic

Column A	(a)	(b)	(c)	(d)	(e)
Column B					

(5 marks)

QUESTION 4

1. State whether the following statements are **TRUE** or **FALSE.**

(a) The extended family comprises of one parent and children only. .....

(b) In the past, children were working at an early age. .....

(c) Malaria was one of the diseases in Mauritius in the 1960s. .....

(d) Seychelles is part of the Republic of Mauritius. .....

(e) Newspaper is an example of social media. .....

(5 marks)

2. Complete the following sentences.

(a) A nuclear family consists of.....

(b) Crime means any action that is .....

(c) Population structure is .....

(3 marks)

QUESTION 5

The bar graph below shows the number of Mauritians who have settled abroad in the year 2000.

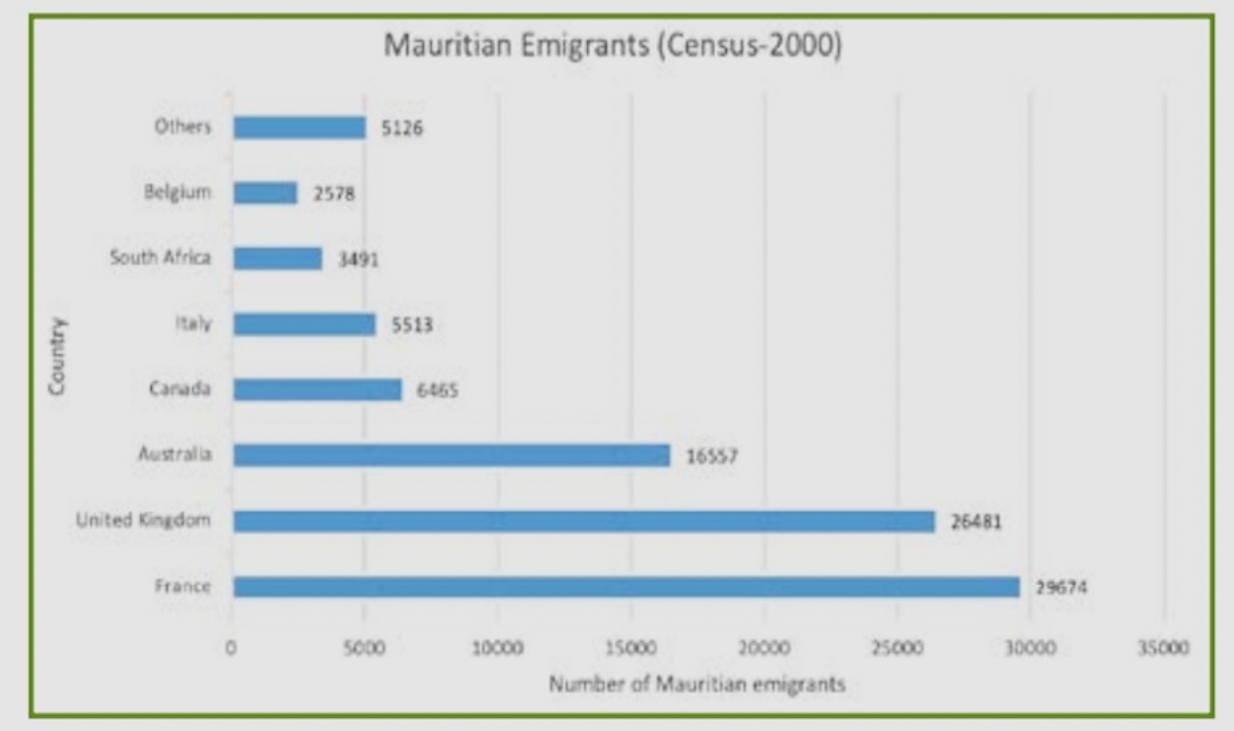

1. Study the bar graph and complete the sentences below.

(a) France has the ..... number of Mauritian emigrants.

(highest, lowest).

(b) More Mauritians emigrated to Australia than .....

(South Africa, United Kingdom).

(c) The lowest number of Mauritians emigrated to .....

(Canada, Belgium).

(3 marks)

2. (a) Give one reason why people settle in other countries.

.....

..... **(1 mark)**

(b) Name three other countries where Mauritians have emigrated.

(i) .....

(ii) .....

(iii) ..... **(3 marks)**

QUESTION 6

1 (a) Give **three** examples of social media.

(i) .....

(ii) .....

(iii) ..... **(3 marks)**

(b) State **one** reason why people use social media.

..... **(1 mark)**

2 (a) Give **two** examples of deviant behaviour at school.

(i) .....

(ii) ..... **(2 marks)**

(b) Give **two** examples of crime.

(i) .....

(ii) ..... **(2 marks)**